Algebra

Math

Name_____ Class_____ Date_____

1 Evaluate the equation, then decide if the statement is **true** or **false**.

15 – 12 = 3

A true
B false

2 Evaluate the equation, then decide if the statement is **true** or **false**.

10 – 12 = -3

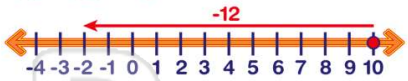

A true
B false

3 Evaluate the equation, then decide if the statement is **true** or **false**.

5 – 11 = -6

4 Evaluate the equation, then decide if the statement is **true** or **false**.

-4 + 20 = 16

PREVIEW

Please Sign In or Sign Up to download the printable version of this worksheet

5

7

A true
B false

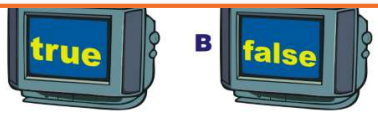

A true
B false

9 Evaluate the equation, then decide if the statement is **true** or **false**.

-6 + 6 = 0

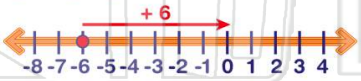

A true
B false

10 Evaluate the equation, then decide if the statement is **true** or **false**.

8 – 10 = -2

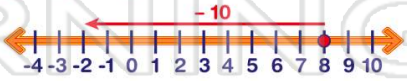

A true
B false

© Copyright NewPath Learning. All Rights Reserved. Permission is granted for the purchaser to print copies for non-commercial educational purposes only. Visit us at www.NewPathWorksheets.com

Algebra

Math

Name_____ Class_____ Date_____

1 Evaluate the equation, then decide if the statement is **true** or **false**.

15 – 12 = 3

A true
B false

A

2 Evaluate the equation, then decide if the statement is **true** or **false**.

10 – 12 = -3

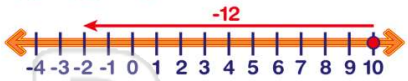

A true
B false

B

3 Evaluate the equation, then decide if the statement is **true** or **false**.

5 – 11 = -6

A

4 Evaluate the equation, then decide if the statement is **true** or **false**.

-4 + 20 = 16

A

5

A

7

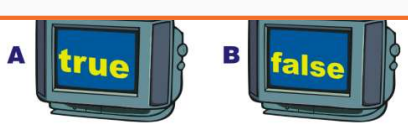

A true
B false

B

9 Evaluate the equation, then decide if the statement is **true** or **false**.

-6 + 6 = 0

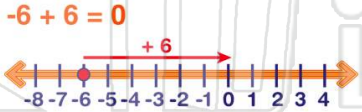

A true
B false

A

10 Evaluate the equation, then decide if the statement is **true** or **false**.

8 – 10 = -2

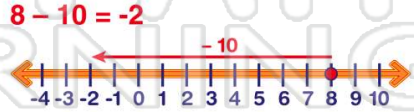

A true
B false

A

PREVIEW

Please Sign In or Sign Up to download the printable version of this worksheet

© Copyright NewPath Learning. All Rights Reserved. Permission is granted for the purchaser to print copies for non-commercial educational purposes only. Visit us at www.NewPathWorksheets.com